Finding Angles within Shapes Name:

Count the number of Acute, Obtuse and Right angles inside each shape.

Ex)

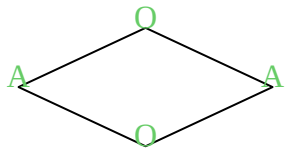

1)

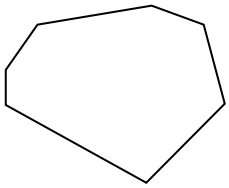

2)

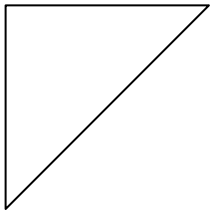

3)

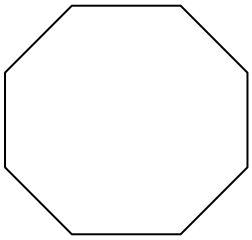

4)

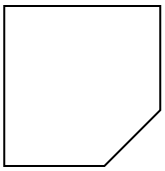

5)

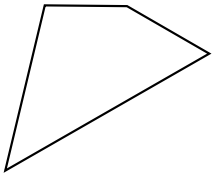

6)

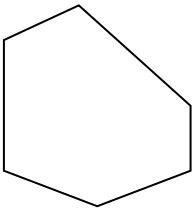

7)

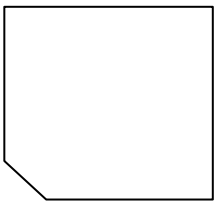

8)

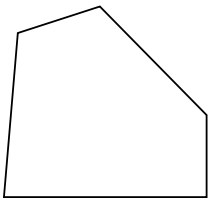

9)

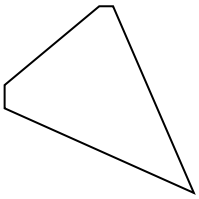

10)

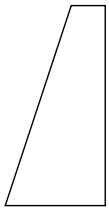

11)

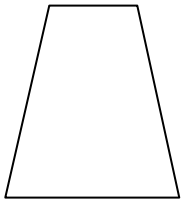

Answers

	A	O	R
Ex.	2	2	0
1.			
2.			
3.			
4.			
5.			
6.			
7.			
8.			
9.			
10.			
11.			

1-10	91	82	73	64	55	45	36	27	18	9
11	0									

Finding Angles within Shapes

Name: **Answer Key**

Count the number of Acute, Obtuse and Right angles inside each shape.

Ex)

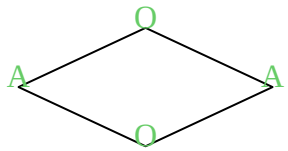

1)

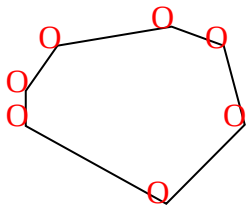

2)

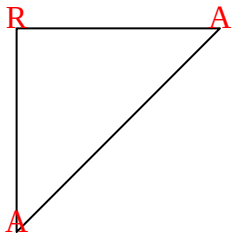

3)

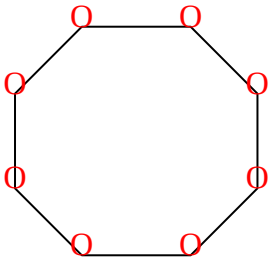

4)

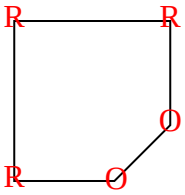

5)

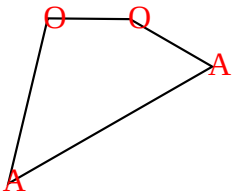

6)

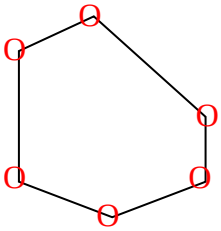

7)

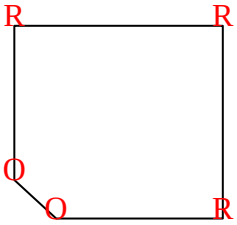

8)

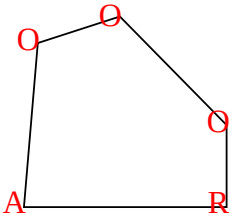

9)

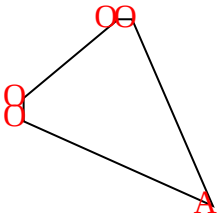

10)

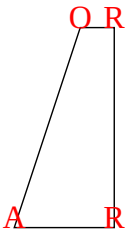

11)

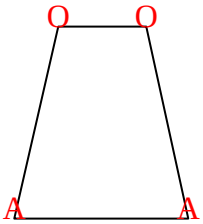

Answers

	A	O	R
Ex.	2	2	0
1.	0	7	0
2.	2	0	1
3.	0	8	0
4.	0	2	3
5.	2	2	0
6.	0	6	0
7.	0	2	3
8.	1	3	1
9.	1	4	0
10.	1	1	2
11.	2	2	0

1-10	91	82	73	64	55	45	36	27	18	9
11	0									

Finding Angles within Shapes Name:

Count the number of Acute, Obtuse and Right angles inside each shape.

Ex)

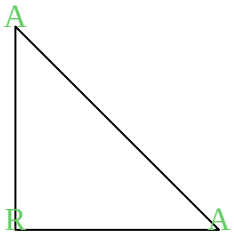

1)

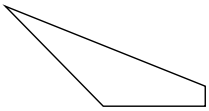

2)

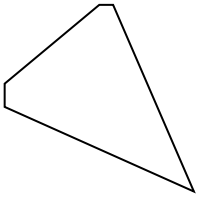

3)

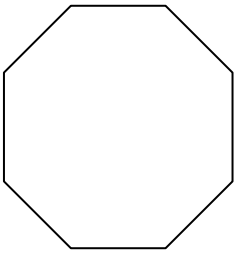

4)

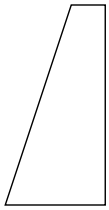

5)

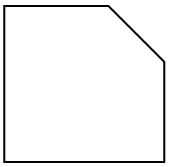

6)



7)



8)

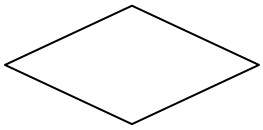

9)



10)

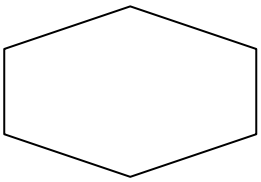

11)

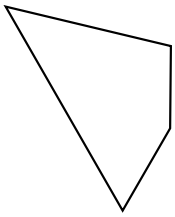

Answers

	A	O	R
Ex.	2	0	1
1.			
2.			
3.			
4.			
5.			
6.			
7.			
8.			
9.			
10.			
11.			

1-10	91	82	73	64	55	45	36	27	18	9
11	0									

Finding Angles within Shapes

Name: **Answer Key**

Count the number of Acute, Obtuse and Right angles inside each shape.

Ex)

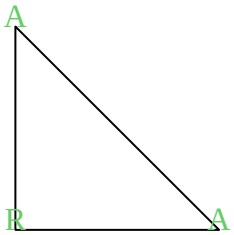

1)

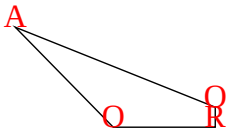

2)

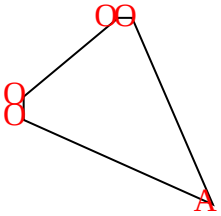

3)

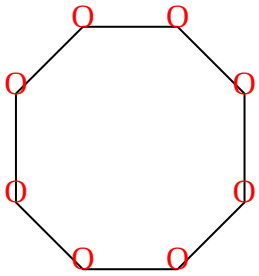

4)

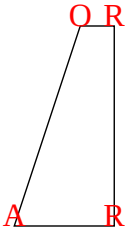

5)

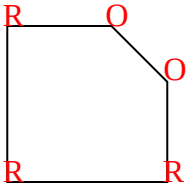

6)

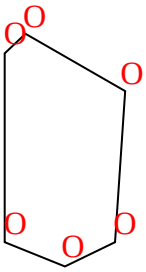

7)



8)

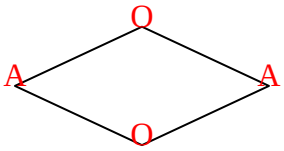

9)

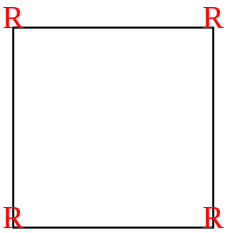

10)

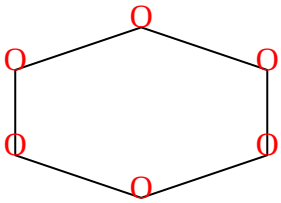

11)

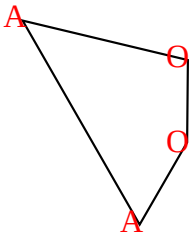

Answers

	A	O	R
Ex.	2	0	1
1.	1	2	1
2.	1	4	0
3.	0	8	0
4.	1	1	2
5.	0	2	3
6.	0	6	0
7.	0	0	4
8.	2	2	0
9.	0	0	4
10.	0	6	0
11.	2	2	0

1-10	91	82	73	64	55	45	36	27	18	9
11	0									

Finding Angles within Shapes

Name:

Count the number of Acute, Obtuse and Right angles inside each shape.

Ex)

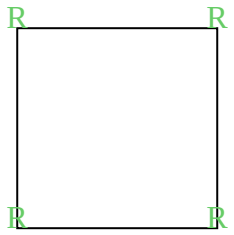

1)

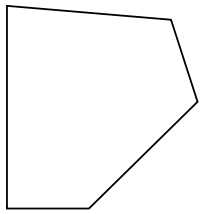

2)



3)



4)

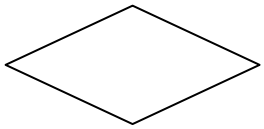

5)

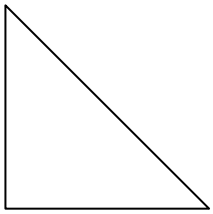

6)

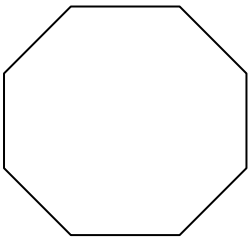

7)

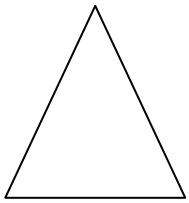

8)

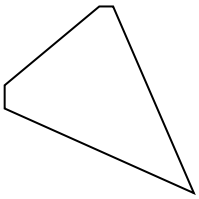

9)

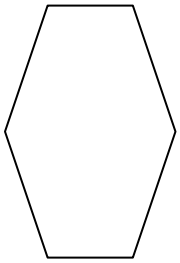

10)

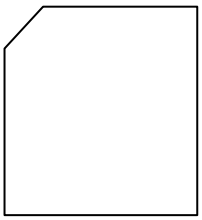

11)

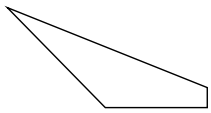

Answers

	A	O	R
Ex.	0	0	4
1.			
2.			
3.			
4.			
5.			
6.			
7.			
8.			
9.			
10.			
11.			

1-10	91	82	73	64	55	45	36	27	18	9
11	0									

Finding Angles within Shapes Name: **Answer Key**

Count the number of Acute, Obtuse and Right angles inside each shape.

Ex)

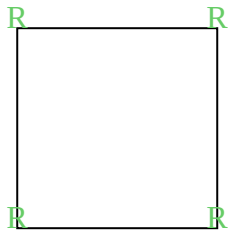

1)

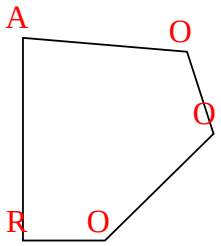

2)

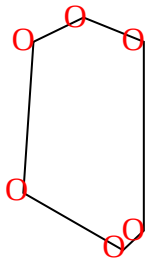

3)



4)

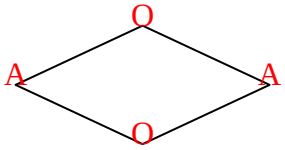

5)

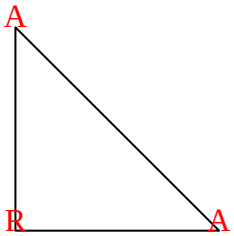

6)

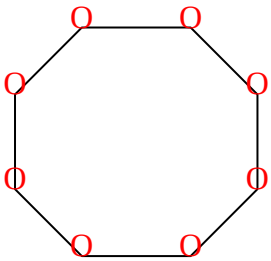

7)

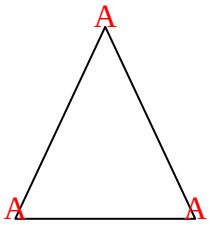

8)

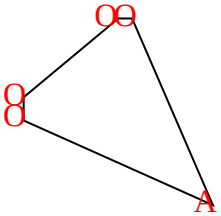

9)

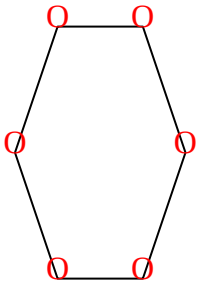

10)

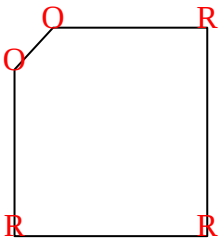

11)

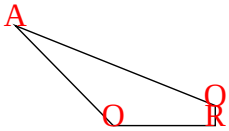

Answers

	A	O	R
Ex.	0	0	4
1.	1	3	1
2.	0	6	0
3.	0	0	4
4.	2	2	0
5.	2	0	1
6.	0	8	0
7.	3	0	0
8.	1	4	0
9.	0	6	0
10.	0	2	3
11.	1	2	1

1-10	91	82	73	64	55	45	36	27	18	9
11	0									

Finding Angles within Shapes Name:

Count the number of Acute, Obtuse and Right angles inside each shape.

Ex)

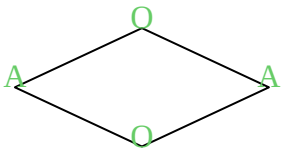

1)

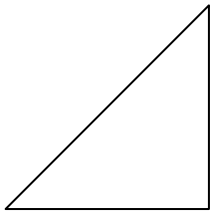

2)

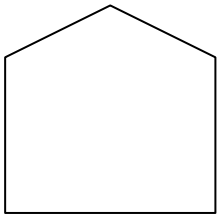

3)

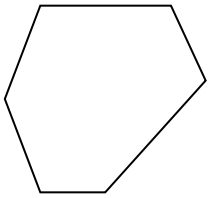

4)

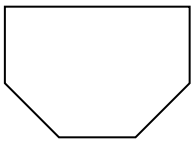

5)

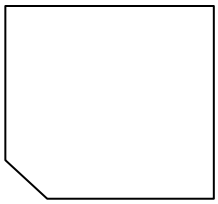

6)

7)

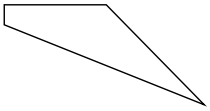

8)

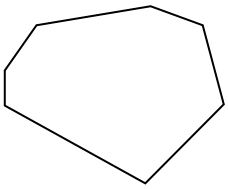

9)

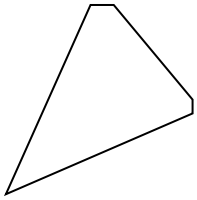

10)

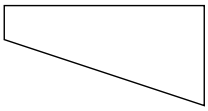

11)

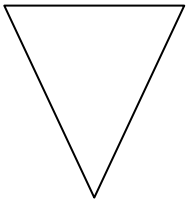

Answers

	A	O	R
Ex.	2	2	0
1.			
2.			
3.			
4.			
5.			
6.			
7.			
8.			
9.			
10.			
11.			

1-10	91	82	73	64	55	45	36	27	18	9
11	0									

Finding Angles within Shapes Name: **Answer Key**

Count the number of Acute, Obtuse and Right angles inside each shape.

Ex)

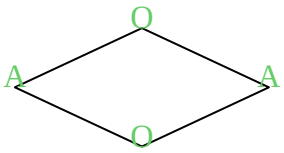

1)

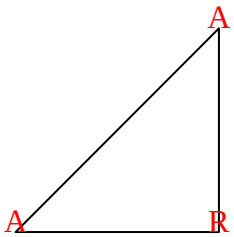

2)

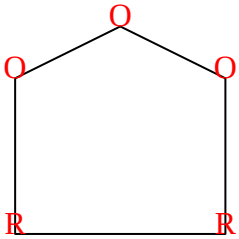

3)

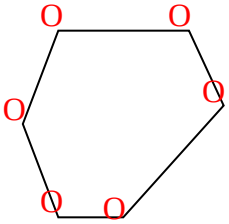

4)

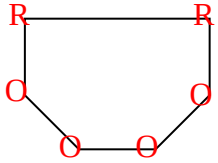

5)

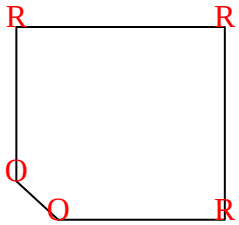

6)



7)

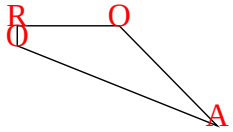

8)

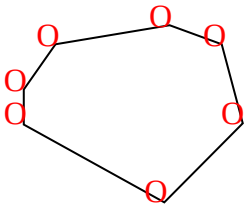

9)

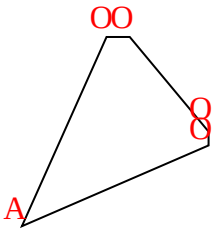

10)

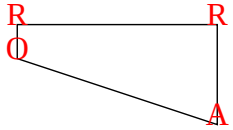

11)

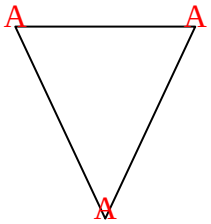

Answers

	A	O	R
Ex.	2	2	0
1.	2	0	1
2.	0	3	2
3.	0	6	0
4.	0	4	2
5.	0	2	3
6.	0	0	4
7.	1	2	1
8.	0	7	0
9.	1	4	0
10.	1	1	2
11.	3	0	0

1-10	91	82	73	64	55	45	36	27	18	9
11	0									

Finding Angles within Shapes

Name:

Count the number of Acute, Obtuse and Right angles inside each shape.

Ex)



1)

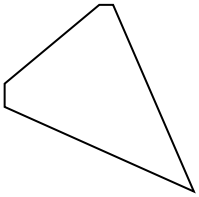

2)

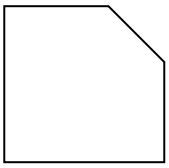

3)

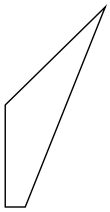

4)

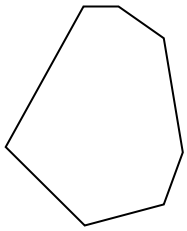

5)



6)

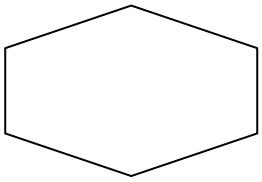

7)

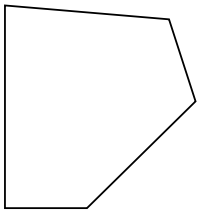

8)

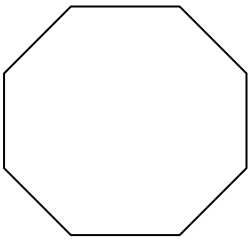

9)

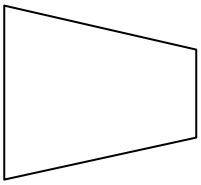

10)

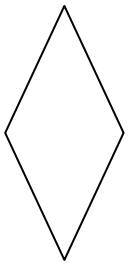

11)

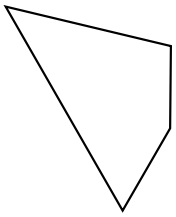

Answers

	A	O	R
Ex.	0	0	4
1.			
2.			
3.			
4.			
5.			
6.			
7.			
8.			
9.			
10.			
11.			

1-10	91	82	73	64	55	45	36	27	18	9
11	0									

Finding Angles within Shapes

Name: **Answer Key**

Count the number of Acute, Obtuse and Right angles inside each shape.

Ex)



1)

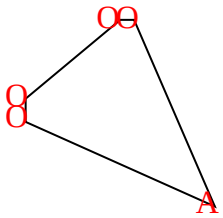

2)

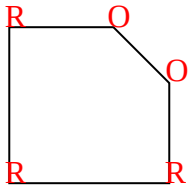

3)

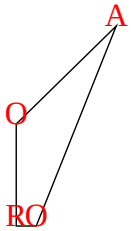

4)

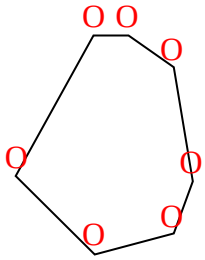

5)

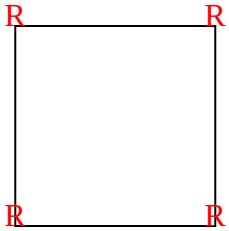

6)

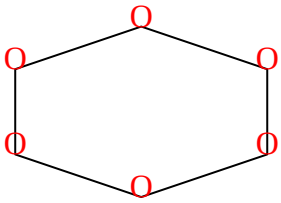

7)

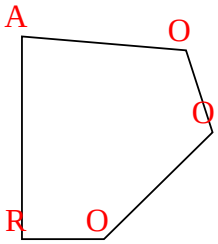

8)

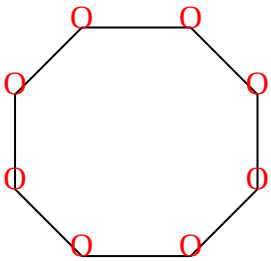

9)

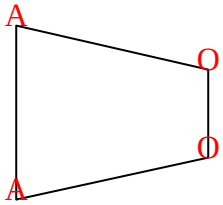

10)

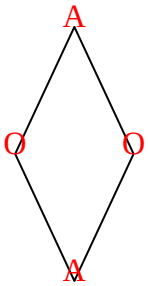

11)

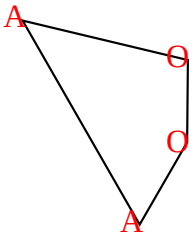

Answers

	A	O	R
Ex.	0	0	4
1.	1	4	0
2.	0	2	3
3.	1	2	1
4.	0	7	0
5.	0	0	4
6.	0	6	0
7.	1	3	1
8.	0	8	0
9.	2	2	0
10.	2	2	0
11.	2	2	0

1-10	91	82	73	64	55	45	36	27	18	9
11	0									

Finding Angles within Shapes

Name:

Count the number of Acute, Obtuse and Right angles inside each shape.

Ex)

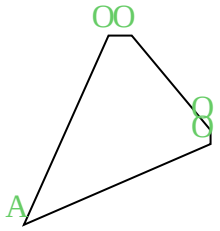

1)



2)



3)

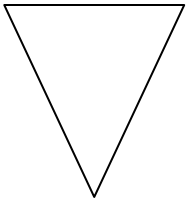

4)

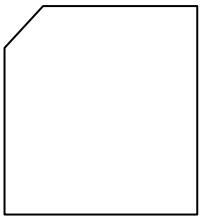

5)

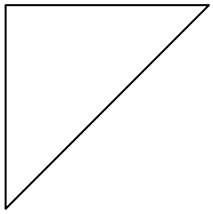

6)

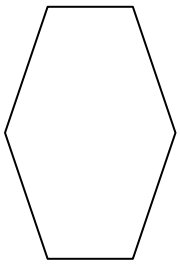

7)

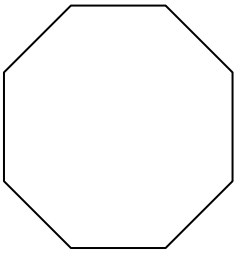

8)

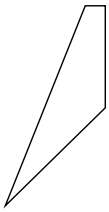

9)



10)

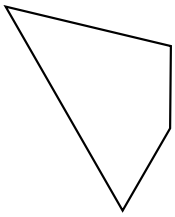

11)

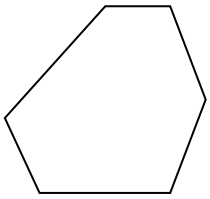

Answers

	A	O	R
Ex.	1	4	0
1.			
2.			
3.			
4.			
5.			
6.			
7.			
8.			
9.			
10.			
11.			

1-10	91	82	73	64	55	45	36	27	18	9
11	0									

Finding Angles within Shapes Name: **Answer Key**

Count the number of Acute, Obtuse and Right angles inside each shape.

Ex)

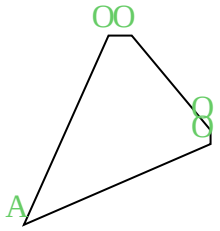

1)

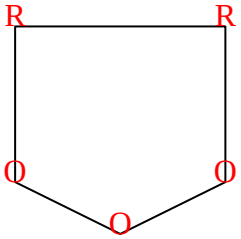

2)

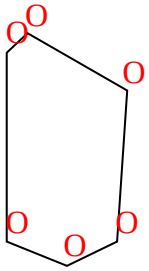

3)

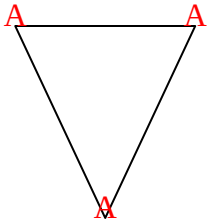

4)

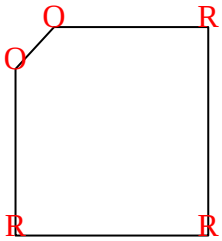

5)

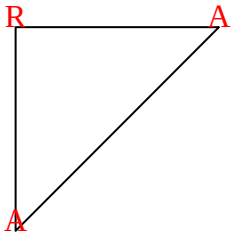

6)

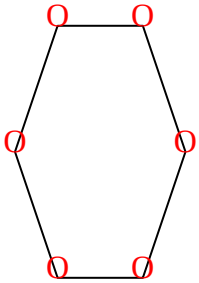

7)

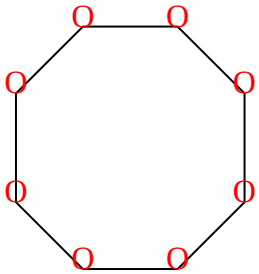

8)

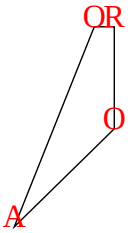

9)



10)

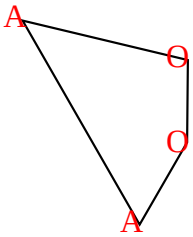

11)

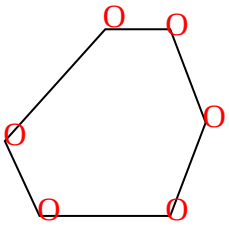

Answers

	A	O	R
Ex.	1	4	0
1.	0	3	2
2.	0	6	0
3.	3	0	0
4.	0	2	3
5.	2	0	1
6.	0	6	0
7.	0	8	0
8.	1	2	1
9.	0	0	4
10.	2	2	0
11.	0	6	0

1-10	91	82	73	64	55	45	36	27	18	9
11	0									

Finding Angles within Shapes

Name:

Count the number of Acute, Obtuse and Right angles inside each shape.

Ex)

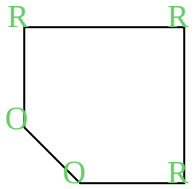

1)

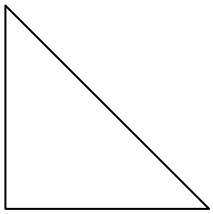

2)

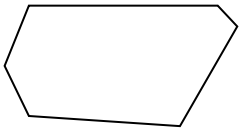

3)

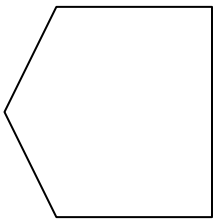

4)

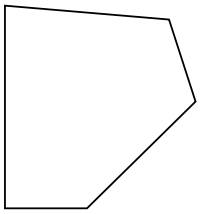

5)

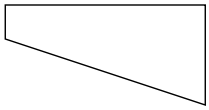

6)

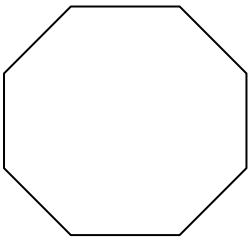

7)



8)



9)

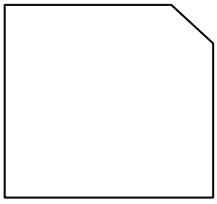

10)

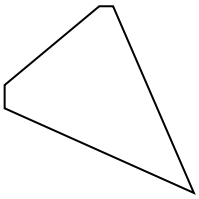

11)

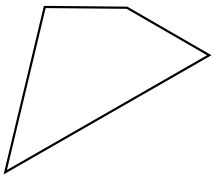

Answers

	A	O	R
Ex.	0	2	3
1.			
2.			
3.			
4.			
5.			
6.			
7.			
8.			
9.			
10.			
11.			

1-10	91	82	73	64	55	45	36	27	18	9
11	0									

Finding Angles within Shapes

Name: **Answer Key**

Count the number of Acute, Obtuse and Right angles inside each shape.

Ex)

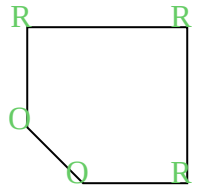

1)

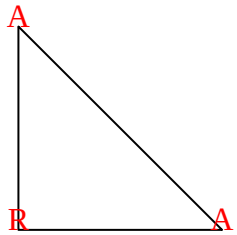

2)

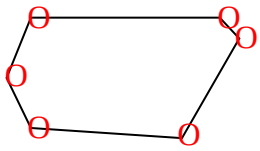

3)

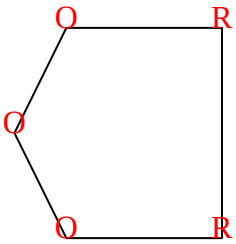

4)

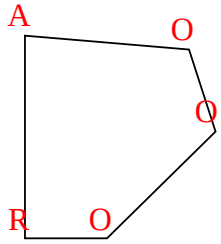

5)

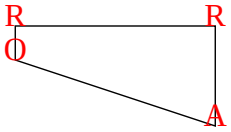

6)

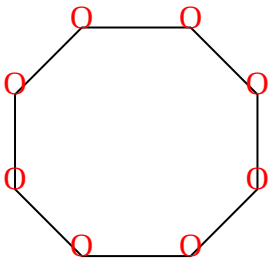

7)

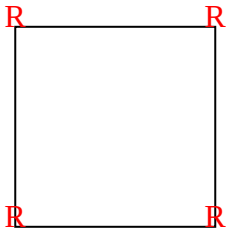

8)



9)

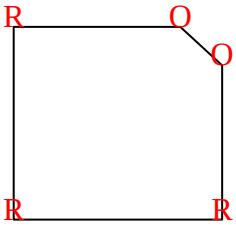

10)

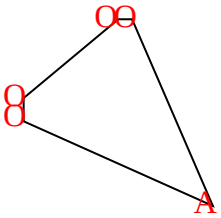

11)

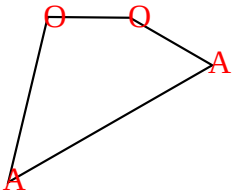

Answers

	A	O	R
Ex.	0	2	3
1.	2	0	1
2.	0	6	0
3.	0	3	2
4.	1	3	1
5.	1	1	2
6.	0	8	0
7.	0	0	4
8.	0	0	4
9.	0	2	3
10.	1	4	0
11.	2	2	0

1-10	91	82	73	64	55	45	36	27	18	9
11	0									

Finding Angles within Shapes

Name:

Count the number of Acute, Obtuse and Right angles inside each shape.

Ex)

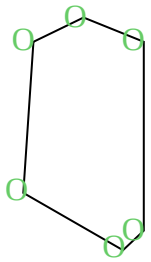

1)

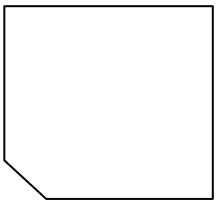

2)

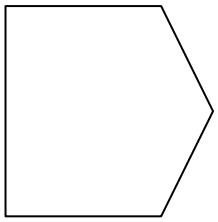

3)

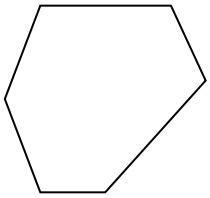

4)

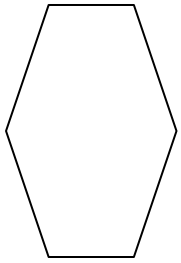

5)

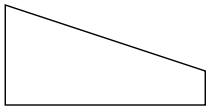

6)

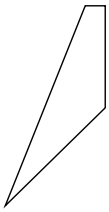

7)

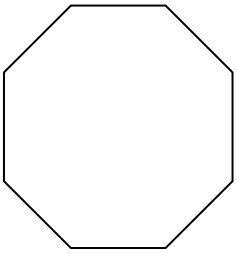

8)



9)



10)

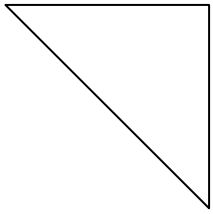

11)

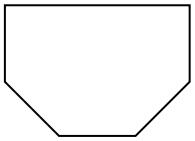

Answers

	A	O	R
Ex.	0	6	0
1.			
2.			
3.			
4.			
5.			
6.			
7.			
8.			
9.			
10.			
11.			

1-10	91	82	73	64	55	45	36	27	18	9
11	0									

Finding Angles within Shapes

Name: **Answer Key**

Count the number of Acute, Obtuse and Right angles inside each shape.

Ex)

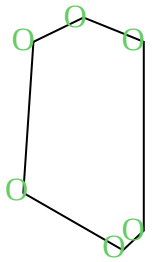

1)

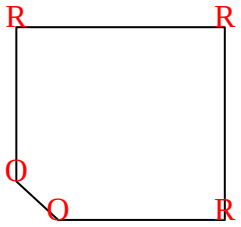

2)

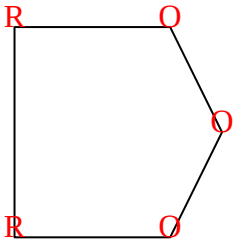

3)

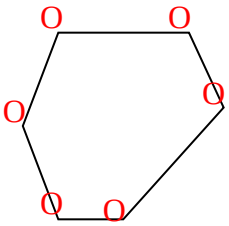

4)

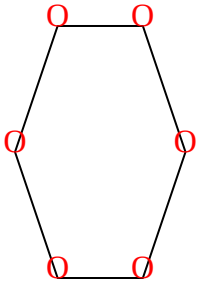

5)

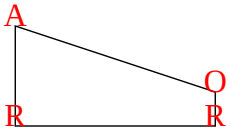

6)

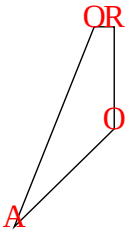

7)

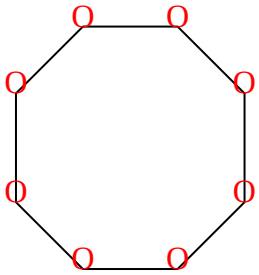

8)



9)

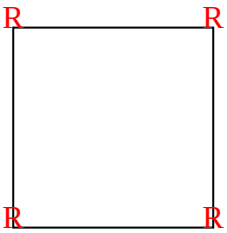

10)

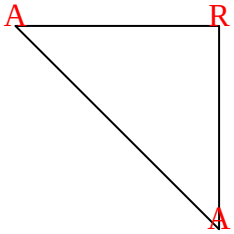

11)

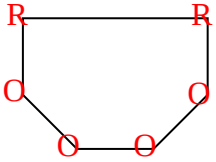

Answers

	A	O	R
Ex.	0	6	0
1.	0	2	3
2.	0	3	2
3.	0	6	0
4.	0	6	0
5.	1	1	2
6.	1	2	1
7.	0	8	0
8.	0	0	4
9.	0	0	4
10.	2	0	1
11.	0	4	2

1-10	91	82	73	64	55	45	36	27	18	9
11	0									

Finding Angles within Shapes Name:

Count the number of Acute, Obtuse and Right angles inside each shape.

Ex)

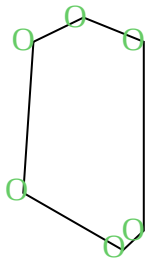

1)



2)

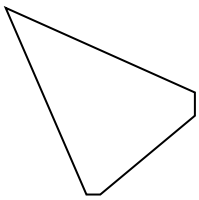

3)

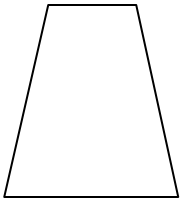

4)

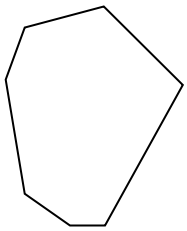

5)

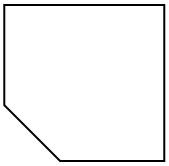

6)

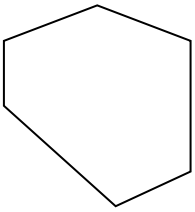

7)

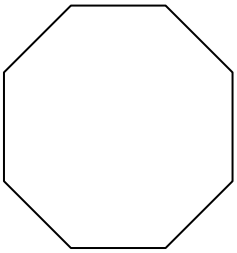

8)

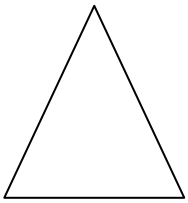

9)

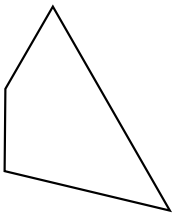

10)

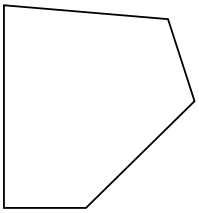

11)

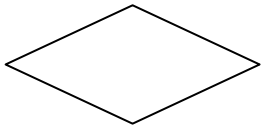

Answers

	A	O	R
Ex.	0	6	0
1.			
2.			
3.			
4.			
5.			
6.			
7.			
8.			
9.			
10.			
11.			

1-10	91	82	73	64	55	45	36	27	18	9
11	0									

Finding Angles within Shapes

Name: **Answer Key**

Count the number of Acute, Obtuse and Right angles inside each shape.

Ex)

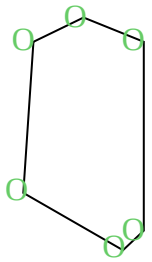

1)

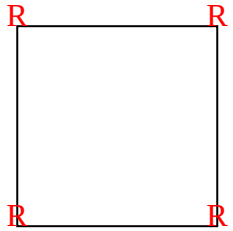

2)

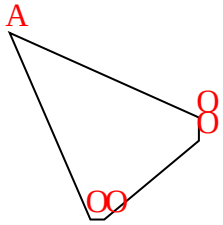

3)

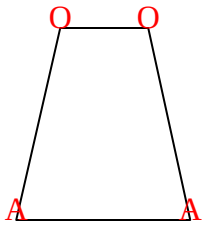

4)

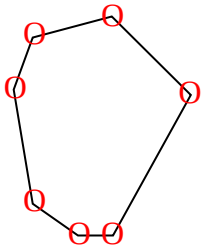

5)

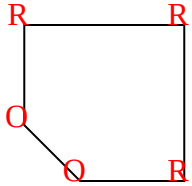

6)

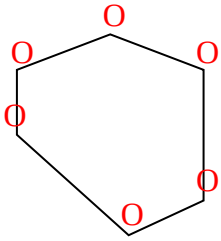

7)

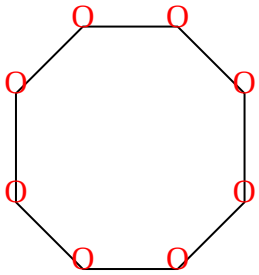

8)

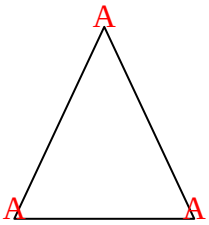

9)

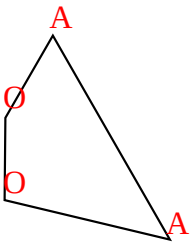

10)

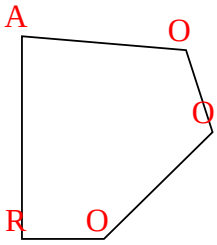

11)

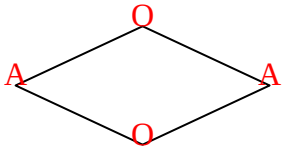

Answers

	A	O	R
Ex.	0	6	0
1.	0	0	4
2.	1	4	0
3.	2	2	0
4.	0	7	0
5.	0	2	3
6.	0	6	0
7.	0	8	0
8.	3	0	0
9.	2	2	0
10.	1	3	1
11.	2	2	0

1-10	91	82	73	64	55	45	36	27	18	9
11	0									

Finding Angles within Shapes

Name:

Count the number of Acute, Obtuse and Right angles inside each shape.

Ex)

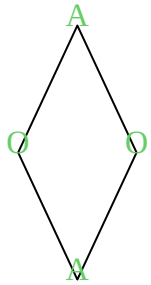

1)

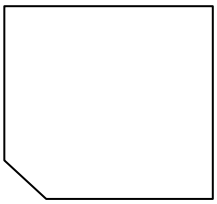

2)

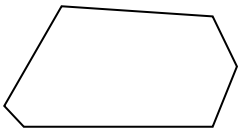

3)

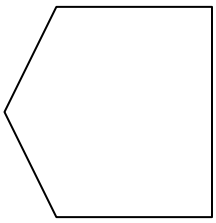

4)

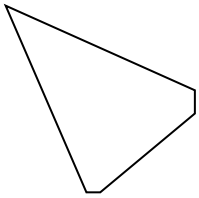

5)

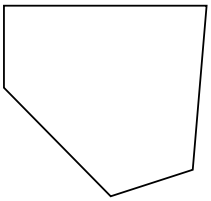

6)

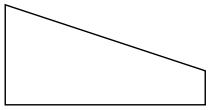

7)



8)

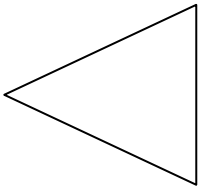

9)

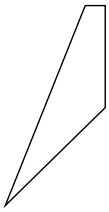

10)

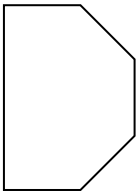

11)

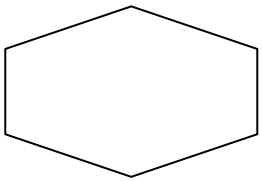

Answers

	A	O	R
Ex.	2	2	0
1.			
2.			
3.			
4.			
5.			
6.			
7.			
8.			
9.			
10.			
11.			

1-10	91	82	73	64	55	45	36	27	18	9
11	0									

Finding Angles within Shapes Name: **Answer Key**

Count the number of Acute, Obtuse and Right angles inside each shape.

Ex)

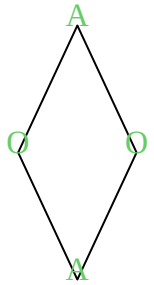

1)

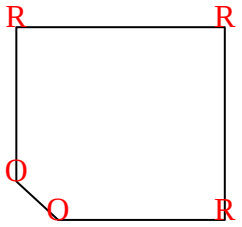

2)

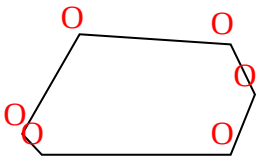

3)

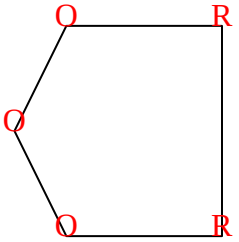

4)

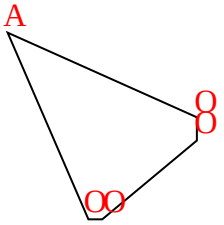

5)

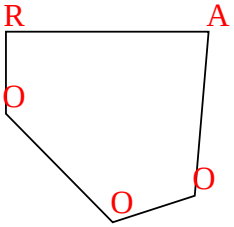

6)

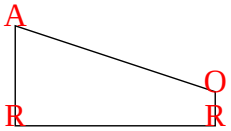

7)

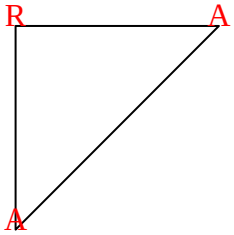

8)

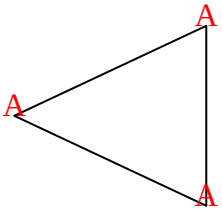

9)

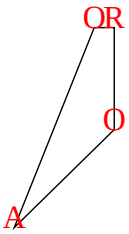

10)

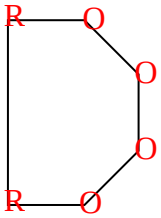

11)

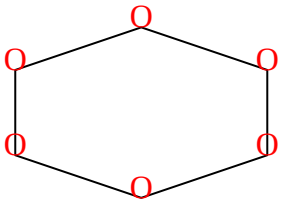

Answers

	A	O	R
Ex.	2	2	0
1.	0	2	3
2.	0	6	0
3.	0	3	2
4.	1	4	0
5.	1	3	1
6.	1	1	2
7.	2	0	1
8.	3	0	0
9.	1	2	1
10.	0	4	2
11.	0	6	0

1-10	91	82	73	64	55	45	36	27	18	9
11	0									